Assignment 2

Simple Meters, Clarifying Meter and Syncopation

1. Below are examples whose rhythmic notation does not reflect the given meter clearly. Clarify the meter by renotating each example with beams of appropriate length. (10 points)

   A.

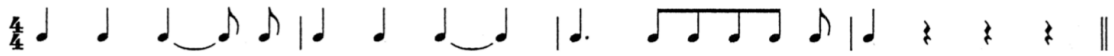

   B. Clarify the meter and add bar lines based on the time signature.



2. For each example, specify the implied time signature and the meter (e.g., “simple duple”). (10 points)



   Time Signature: Meter:



   Time Signature: Meter:

3. Below are melodic fragments that illustrate syncopation. Use brackets to indicate where syncopation occurs.(10 points)

   a.



   b.